Multiplication sentences from pictures

1 Complete the sentences to match the picture.

a)



☐ lots of 3 = ☐

☐ multiplied by 3 = ☐

☐ × 3 = ☐

b)



☐ lots of 6 = ☐

☐ multiplied by 6 = ☐

☐ × 6 = ☐

c)

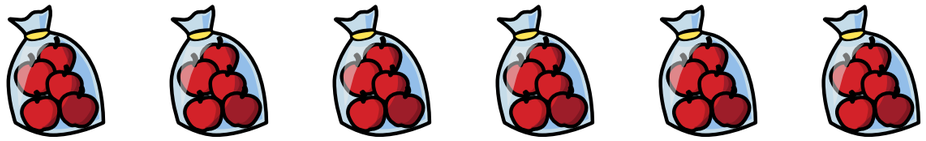

☐ lots of ☐ = ☐

☐ multiplied by ☐ = ☐

☐ × ☐ = ☐

d)

☐ lots of ☐ = ☐

☐ multiplied by ☐ = ☐

☐ × ☐ = ☐

© White Rose Maths 2019

2 Draw a picture for each sentence.

a) 4 lots of 5

b) 2 multiplied by 4

c) 3 × 5

3 Complete the sentences for each picture.

a)



☐ lots of ☐ = ☐

☐ × ☐ = ☐

b)

☐ lots of ☐ = ☐

☐ × ☐ = ☐

What is the same about the number sentences?

What is different?

4 **a)** The answer is 12

What could the multiplication be?

_____

Compare answers with a partner.

b) Now the answer is 15

What could the multiplication be?

_____

Can you write more or fewer multiplications for 15?

© White Rose Maths 2019