Count money – pounds

1 Match the coin or note to its value.

£5
£1
£50
£20
£10
£2

2 How much money is there?

a)

b)

c)

d)

e)

3 How much money is there?

a)

b)

c)

© White Rose Maths 2019

4 Complete the bar models.

a)



b)



c)

5 Write <, > or = to compare the money.

a)

b)

c)

d)

6 Dora has this money.

Ron has this money.



Is Ron correct? _____

How do you know?

7 Mo has this money.

Do you agree with Mo?

Talk about it with a partner.

© White Rose Maths 2019